Classifying Quadrilaterals

Complete the boxes on the sheet with as much detail as you can about each shape. Mark Equal Sides, Parallel Lines and Equal Angles.

	Name the Shape.	Describe the sides. Are they Parallel? Are they Equal?
		
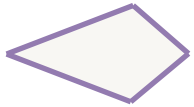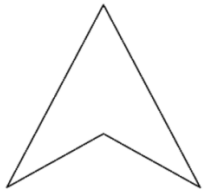
	Name	Describe the sides. Are they Parallel? Are they Equal?