Percentage, Decimal and Fraction Colouring Activity

10%

Shade in 10%



$\frac{____}{100} = ____ = 0.___$

20%

Shade in 20%



$\frac{____}{100} = ____ = 0.___$

30%

Shade in 30%



$\frac{____}{100} = ____ = 0.___$

40%

Shade in 40%



$\frac{____}{100} = ____ = 0.___$

visit twinkl.com

50%

Shade in 50%



$\frac{____}{100} = ____ = 0.___$

60%

Shade in 60%



$\frac{____}{100} = ____ = 0.___$

70%

Shade in 70%



$\frac{____}{100} = ____ = 0.___$

80%

Shade in 80%



$\frac{____}{100} = ____ = 0.___$

visit twinkl.com

90%

Shade in 90%



$\frac{____}{100} = ____ = 0.___$

100%

Shade in 100%



$\frac{____}{100} = ____$

1%

Shade in 1%



$\frac{____}{100} = ____ = 0.___$

5%

Shade in 5%



$\frac{____}{100} = ____ = 0.___$

visit twinkl.com

12%

Shade in 12%



$\frac{____}{100} = ____ = 0.___$

25%

Shade in 25%



$\frac{____}{100} = ____ = 0.___$

75%

Shade in 75%



$\frac{____}{100} = ____ = 0.___$

visit twinkl.com